Name _____ Date _____

Bills and coins puzzle no. 17

Count the bills and coins. Write each total like $6.85.

1

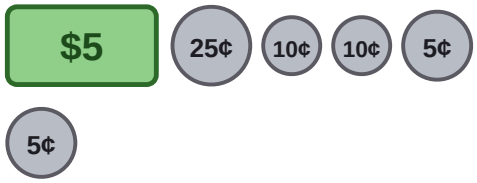

_____

2



_____

3

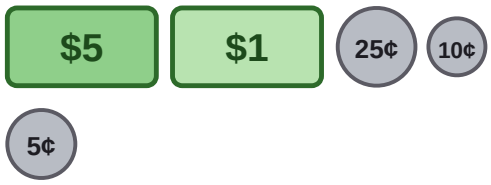

_____

4

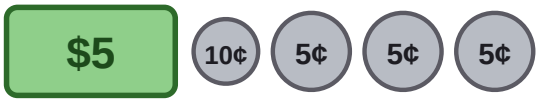

_____

5



_____

6



_____

7



_____

8

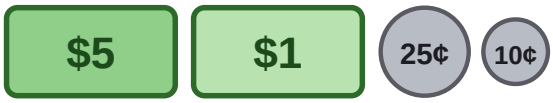

_____

9

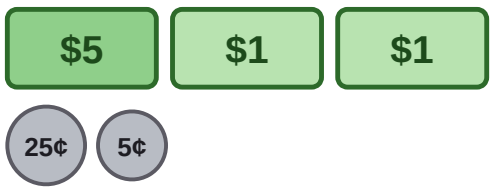

_____

10

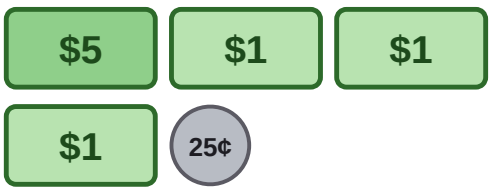

_____

Name _____ Date _____

Answer key: Bills and coins puzzle no. 17

Count the bills and coins. Write each total like $6.85.

1

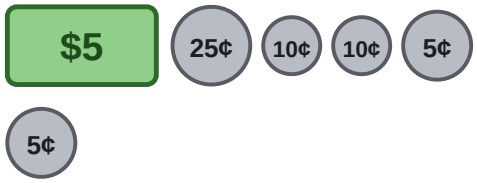

$5.55

2



$5.15

3

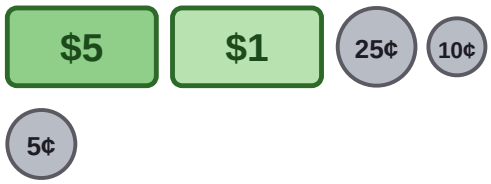

$6.40

4

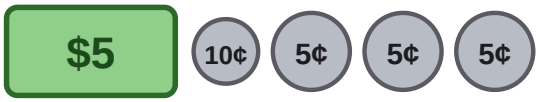

$5.25

5



$6.25

6



$6.10

7



$10.00

8

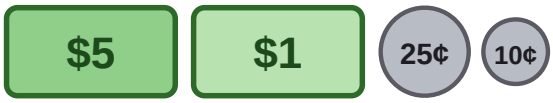

$6.35

9

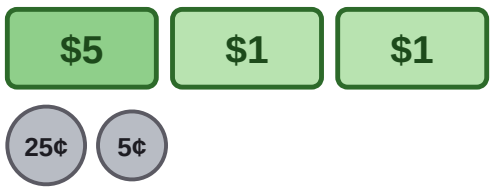

$7.30

10

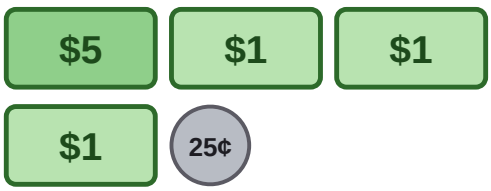

$8.25