Name _____ Date _____

Bills and coins puzzle no. 18

Count the bills and coins. Write each total like $6.85.

1



_____

2



_____

3

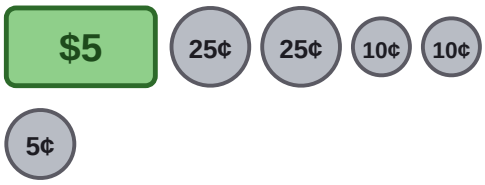

_____

4

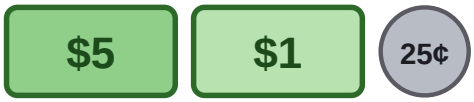

_____

5



_____

6

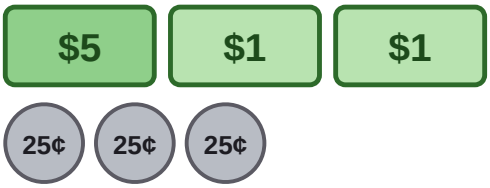

_____

7

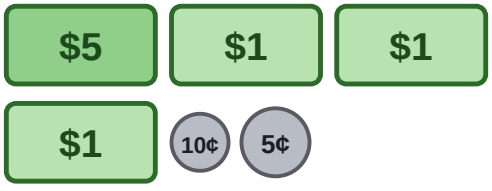

_____

8

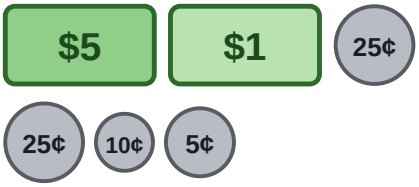

_____

9

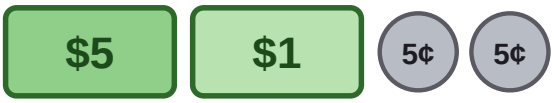

_____

10

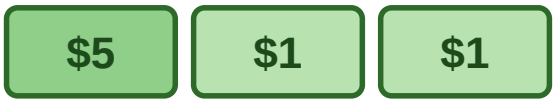

_____

Name _____ Date _____

Answer key: Bills and coins puzzle no. 18

Count the bills and coins. Write each total like $6.85.

1



$5.15

2



$10.00

3

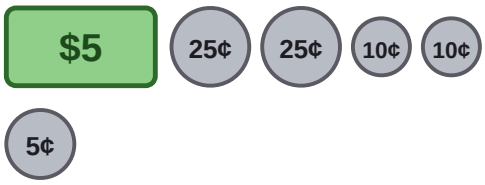

$5.75

4

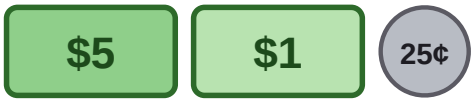

$6.25

5



$5.30

6

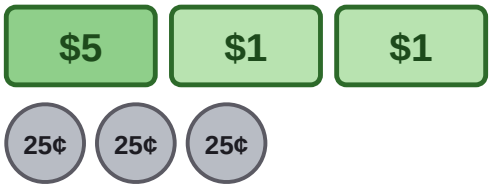

$7.75

7

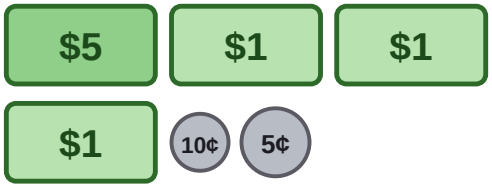

$8.15

8

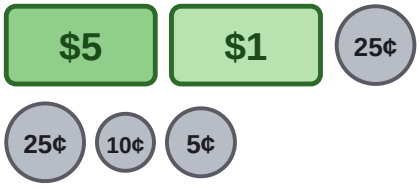

$6.65

9

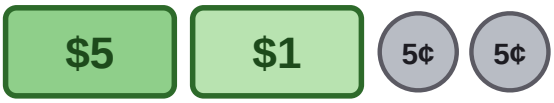

$6.10

10

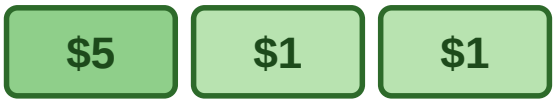

$7.00