Name _____ Date _____

Bills and coins puzzle no. 2

Count the bills and coins. Write each total like $6.85.

1



_____

2



_____

3



_____

4

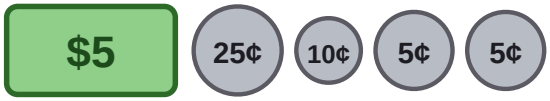

_____

5



_____

6



_____

7

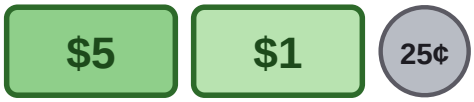

_____

8



_____

9



_____

10

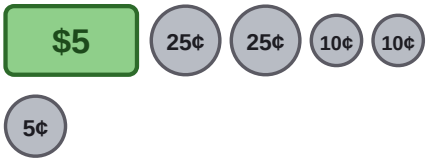

_____

Name _____ Date _____

Answer key: Bills and coins puzzle no. 2

Count the bills and coins. Write each total like $6.85.

1



$10.00

2



$6.50

3



$5.15

4



$5.45

5



$5.10

6



$5.45

7

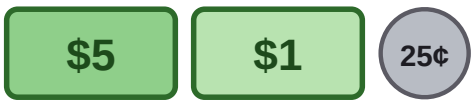

$6.25

8



$5.40

9



$5.20

10

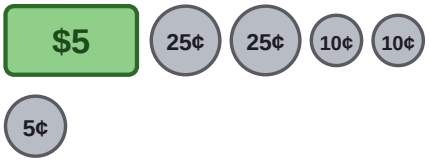

$5.75