Name _____ Date _____

Bills and coins puzzle no. 20

Count the bills and coins. Write each total like $6.85.

1

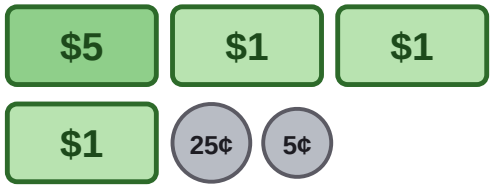

_____

2



_____

3



_____

4



_____

5

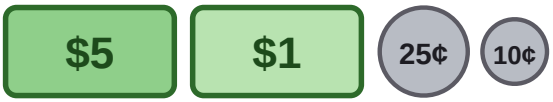

_____

6

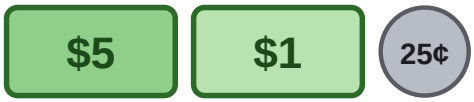

_____

7

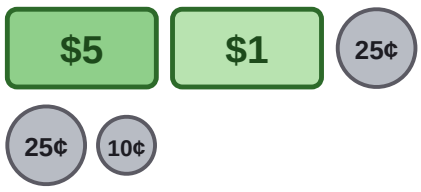

_____

8



_____

9

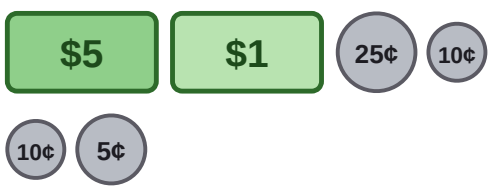

_____

10



_____

Name _____ Date _____

Answer key: Bills and coins puzzle no. 20

Count the bills and coins. Write each total like $6.85.

1

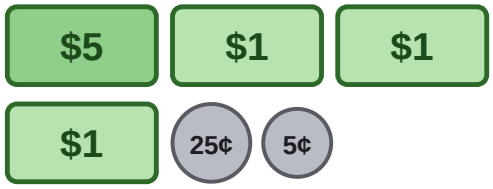

$8.30

2



$5.35

3



$6.15

4



$10.00

5

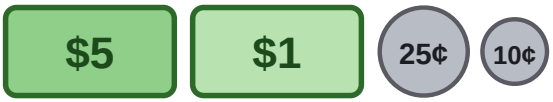

$6.35

6

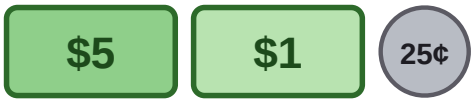

$6.25

7

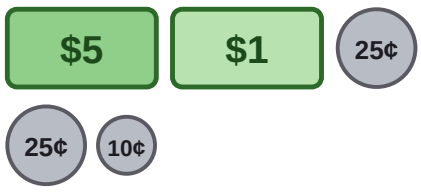

$6.60

8



$5.15

9

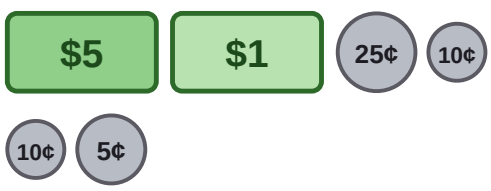

$6.50

10



$6.30