Name _____ Date _____

Bills and coins puzzle no. 3

Count the bills and coins. Write each total like $6.85.

1

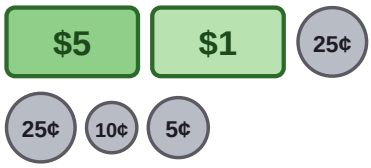

_____

2

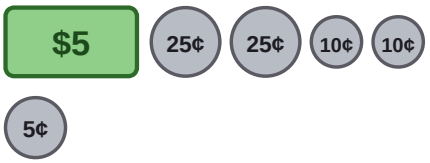

_____

3

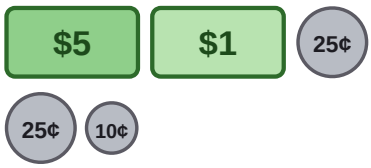

_____

4



_____

5

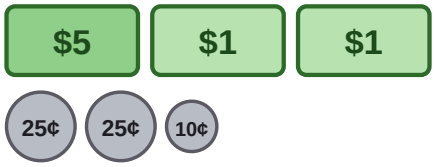

_____

6



_____

7



_____

8

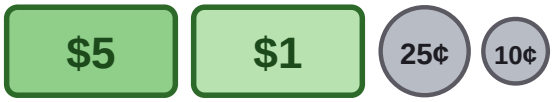

_____

9

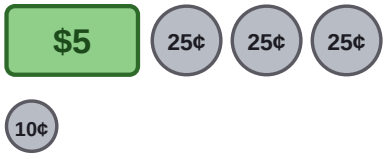

_____

10



_____

Name _____ Date _____

Answer key: Bills and coins puzzle no. 3

Count the bills and coins. Write each total like $6.85.

1

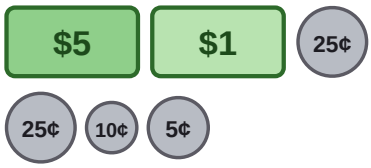

$6.65

2

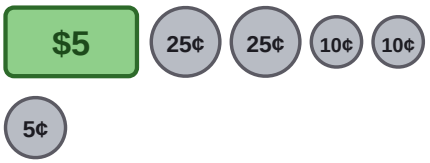

$5.75

3

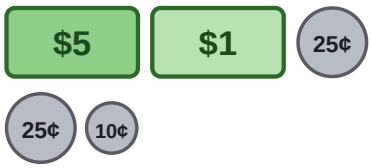

$6.60

4



$10.00

5

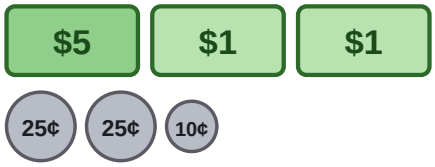

$7.60

6



$7.05

7



$6.25

8

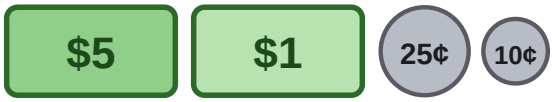

$6.35

9

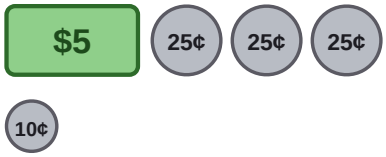

$5.85

10



$5.70