Name _____ Date _____

Bills and coins puzzle no. 4

Count the bills and coins. Write each total like $6.85.

1

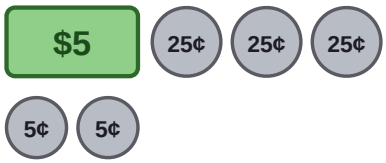

_____

2



_____

3



_____

4

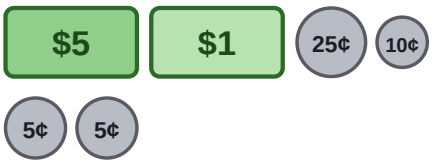

_____

5



_____

6

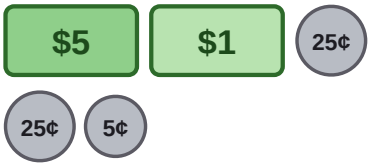

_____

7

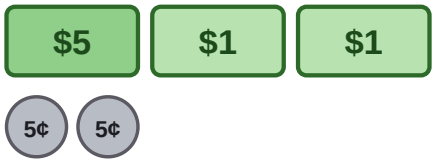

_____

8



_____

9



_____

10

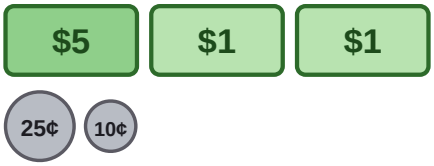

_____

Name _____ Date _____

Answer key: Bills and coins puzzle no. 4

Count the bills and coins. Write each total like $6.85.

1

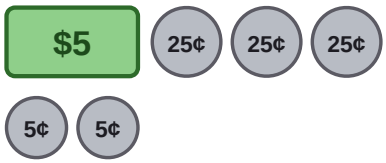

$5.85

2



$5.50

3



$10.00

4

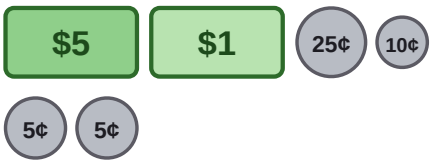

$6.45

5



$7.05

6

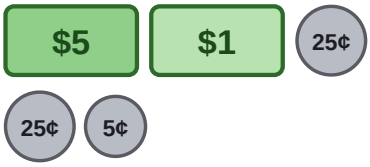

$6.55

7

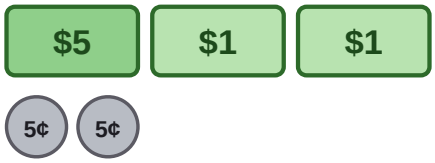

$7.10

8



$5.35

9



$6.50

10

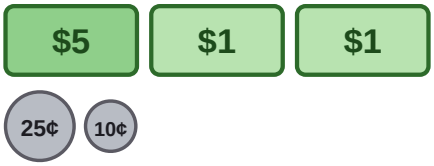

$7.35