Name _____ Date _____

Bills and coins puzzle no. 6

Count the bills and coins. Write each total like $6.85.

1



_____

2

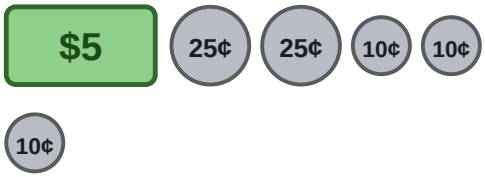

_____

3



_____

4



_____

5

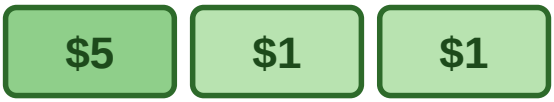

_____

6

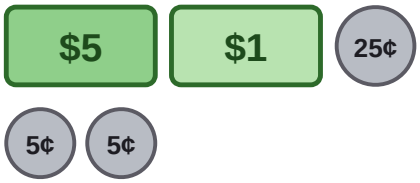

_____

7



_____

8



_____

9



_____

10



_____

Name _____ Date _____

Answer key: Bills and coins puzzle no. 6

Count the bills and coins. Write each total like $6.85.

1



$5.40

2

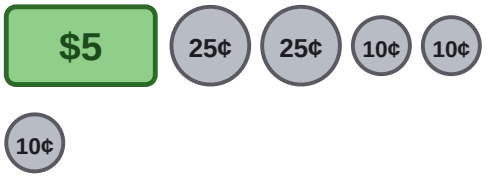

$5.80

3



$5.30

4



$10.00

5

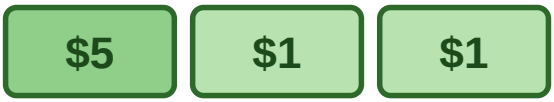

$7.00

6

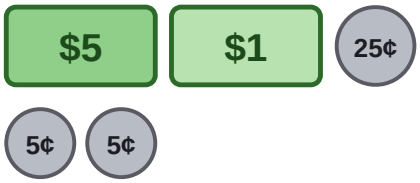

$6.35

7



$5.15

8



$5.50

9



$7.10

10



$5.20