Name _____ Date _____

Bills and coins puzzle no. 7

Count the bills and coins. Write each total like $6.85.

1

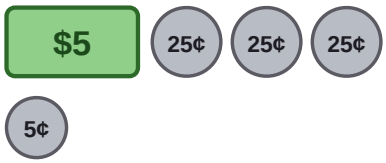

_____

2

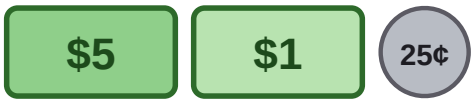

_____

3



_____

4



_____

5

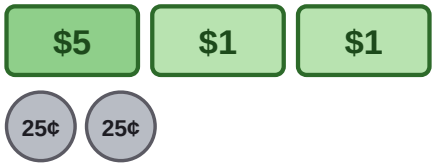

_____

6



_____

7



_____

8

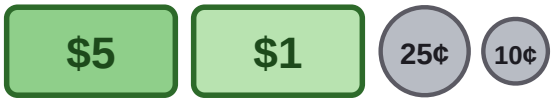

_____

9



_____

10

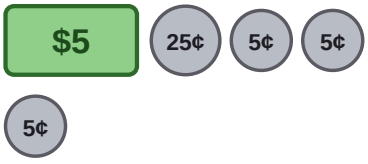

_____

Name _____ Date _____

Answer key: Bills and coins puzzle no. 7

Count the bills and coins. Write each total like $6.85.

1

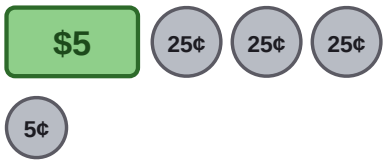

$5.80

2

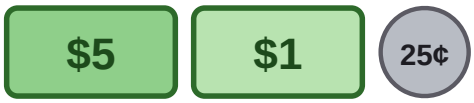

$6.25

3



$10.00

4



$5.50

5

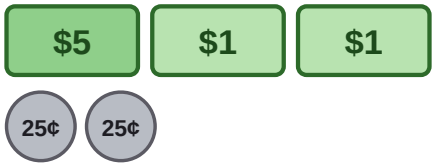

$7.50

6



$5.15

7



$6.25

8

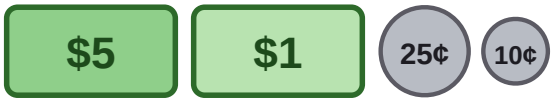

$6.35

9



$5.35

10

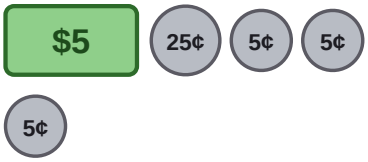

$5.40