Name _____ Date _____

Coins and quarters puzzle no. 10

Count the coins, quarters too. How many cents in each group?

1



_____

2



_____

3



_____

4



_____

5



_____

6

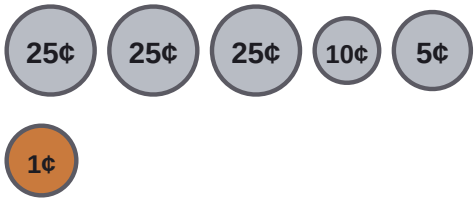

_____

7

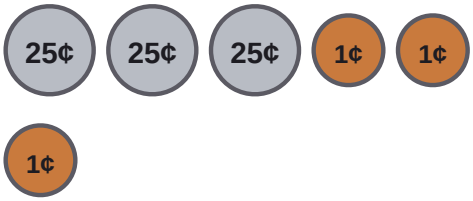

_____

8



_____

Name _____ Date _____

Answer key: Coins and quarters puzzle no. 10

Count the coins, quarters too. How many cents in each group?

1



36¢

2



75¢

3



85¢

4



57¢

5



90¢

6

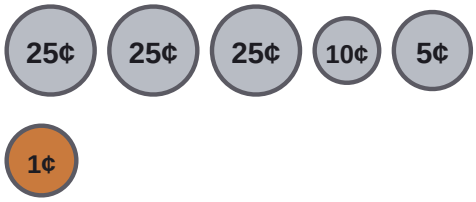

91¢

7

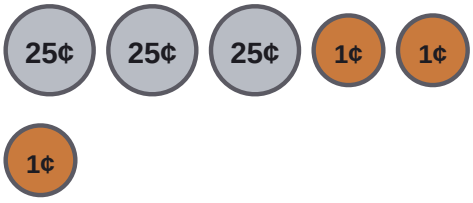

78¢

8



60¢