Name _____ Date _____

Coins and quarters puzzle no. 11

Count the coins, quarters too. How many cents in each group?

1



_____

2



_____

3



_____

4



_____

5



_____

6



_____

7



_____

8



_____

Name _____ Date _____

Answer key: Coins and quarters puzzle no. 11

Count the coins, quarters too. How many cents in each group?

1



70¢

2



36¢

3



37¢

4



71¢

5



50¢

6



60¢

7



76¢

8



86¢