Name _____ Date _____

Coins and quarters puzzle no. 12

Count the coins, quarters too. How many cents in each group?

1



_____

2



_____

3



_____

4

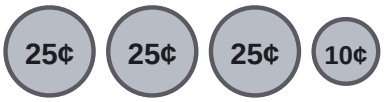

_____

5



_____

6



_____

7

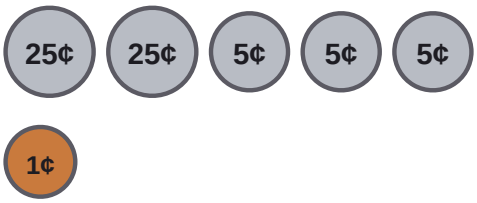

_____

8



_____

Name _____ Date _____

Answer key: Coins and quarters puzzle no. 12

Count the coins, quarters too. How many cents in each group?

1



57¢

2



61¢

3



75¢

4

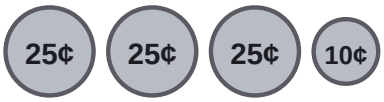

85¢

5



31¢

6



62¢

7

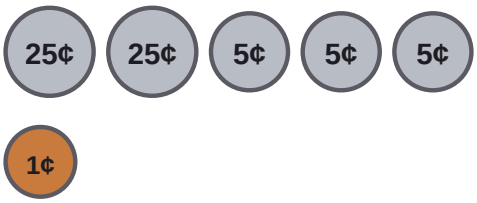

66¢

8



36¢