Name _____ Date _____

Coins and quarters puzzle no. 13

Count the coins, quarters too. How many cents in each group?

1

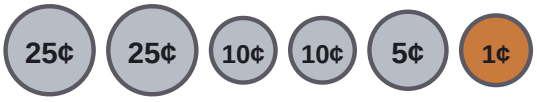

_____

2



_____

3

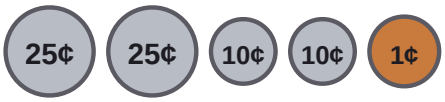

_____

4



_____

5



_____

6



_____

7



_____

8



_____

Name _____ Date _____

Answer key: Coins and quarters puzzle no. 13

Count the coins, quarters too. How many cents in each group?

1

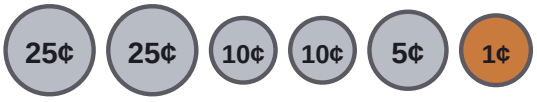

76¢

2



57¢

3

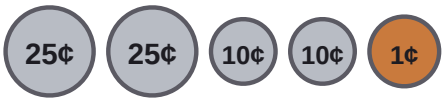

71¢

4



65¢

5



55¢

6



45¢

7



60¢

8



76¢