Name _____ Date _____

Coins and quarters puzzle no. 14

Count the coins, quarters too. How many cents in each group?

1



_____

2



_____

3



_____

4



_____

5



_____

6



_____

7

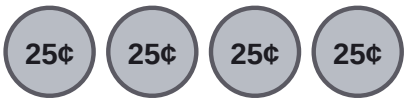

_____

8



_____

Name _____ Date _____

Answer key: Coins and quarters puzzle no. 14

Count the coins, quarters too. How many cents in each group?

1



40¢

2



50¢

3



61¢

4



60¢

5



51¢

6



55¢

7

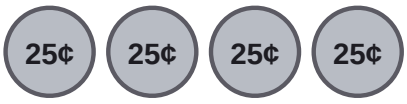

100¢

8



66¢