Name _____ Date _____

Coins and quarters puzzle no. 15

Count the coins, quarters too. How many cents in each group?

1

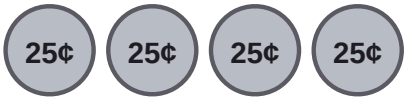

_____

2



_____

3



_____

4



_____

5



_____

6



_____

7

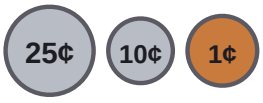

_____

8



_____

Name _____ Date _____

Answer key: Coins and quarters puzzle no. 15

Count the coins, quarters too. How many cents in each group?

1

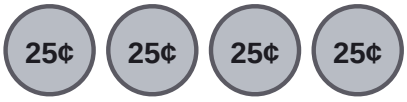

100¢

2



56¢

3



86¢

4



37¢

5



33¢

6



76¢

7



36¢

8



61¢