Name _____ Date _____

Coins and quarters puzzle no. 17

Count the coins, quarters too. How many cents in each group?

1



_____

2



_____

3



_____

4

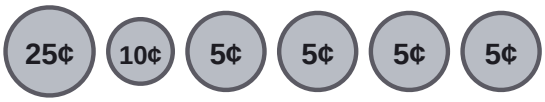

_____

5



_____

6



_____

7



_____

8



_____

Name _____ Date _____

Answer key: Coins and quarters puzzle no. 17

Count the coins, quarters too. How many cents in each group?

1



31¢

2



76¢

3



42¢

4

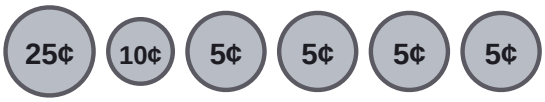

55¢

5



50¢

6



53¢

7



50¢

8



87¢