Name _____ Date _____

Coins and quarters puzzle no. 19

Count the coins, quarters too. How many cents in each group?

1



_____

2

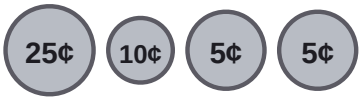

_____

3



_____

4

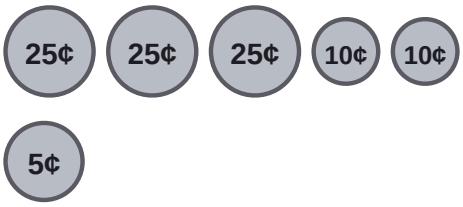

_____

5



_____

6



_____

7



_____

8



_____

Name _____ Date _____

Answer key: Coins and quarters puzzle no. 19

Count the coins, quarters too. How many cents in each group?

1



75¢

2

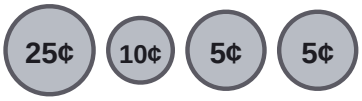

45¢

3



55¢

4

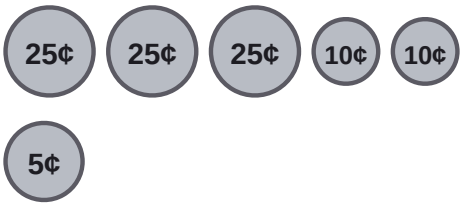

100¢

5



90¢

6



51¢

7



80¢

8



56¢