Name _____ Date _____

Coins and quarters puzzle no. 20

Count the coins, quarters too. How many cents in each group?

1



_____

2



_____

3



_____

4



_____

5



_____

6

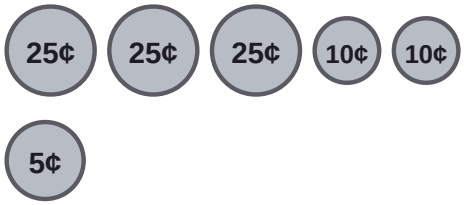

_____

7



_____

8

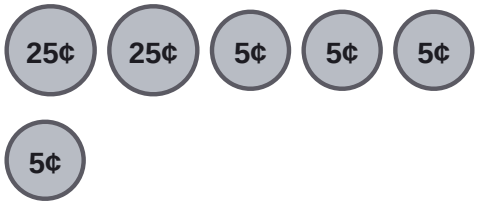

_____

Name _____ Date _____

Answer key: Coins and quarters puzzle no. 20

Count the coins, quarters too. How many cents in each group?

1



85¢

2



36¢

3



90¢

4



62¢

5



36¢

6

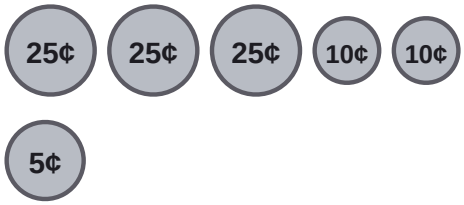

100¢

7



66¢

8

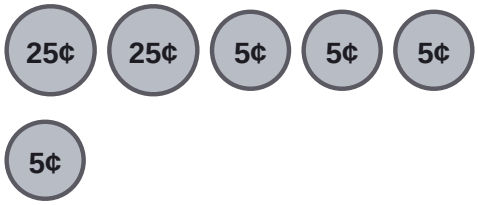

70¢