Name _____ Date _____

Coins and quarters puzzle no. 3

Count the coins, quarters too. How many cents in each group?

1



_____

2



_____

3



_____

4

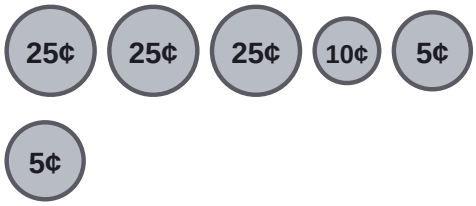

_____

5



_____

6



_____

7



_____

8



_____

Name _____ Date _____

Answer key: Coins and quarters puzzle no. 3

Count the coins, quarters too. How many cents in each group?

1



51¢

2



57¢

3



41¢

4

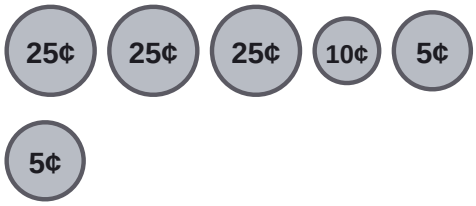

95¢

5



81¢

6



70¢

7



60¢

8



65¢