Name _____ Date _____

Coins and quarters puzzle no. 4

Count the coins, quarters too. How many cents in each group?

1



_____

2



_____

3

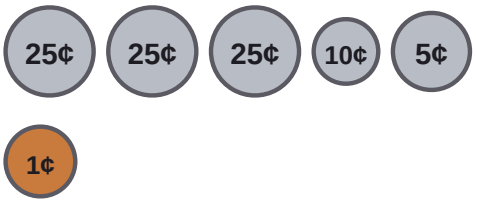

_____

4



_____

5



_____

6

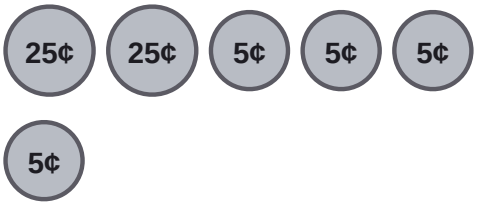

_____

7



_____

8



_____

Name _____ Date _____

Answer key: Coins and quarters puzzle no. 4

Count the coins, quarters too. How many cents in each group?

1



86¢

2



66¢

3

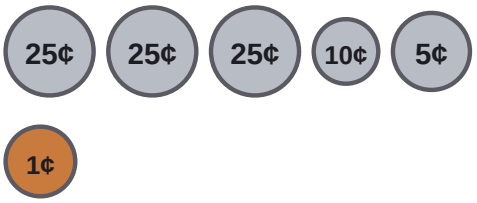

91¢

4



56¢

5



36¢

6

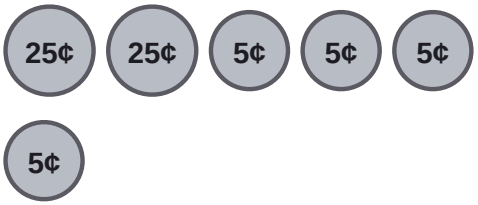

70¢

7



81¢

8



56¢