Name _____ Date _____

Coins and quarters puzzle no. 7

Count the coins, quarters too. How many cents in each group?

1



_____

2



_____

3

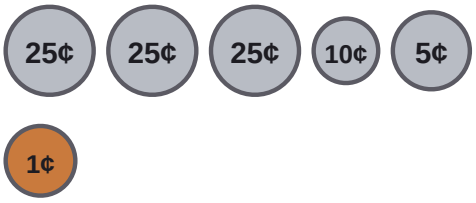

_____

4



_____

5



_____

6



_____

7



_____

8



_____

Name _____ Date _____

Answer key: Coins and quarters puzzle no. 7

Count the coins, quarters too. How many cents in each group?

1



96¢

2



54¢

3

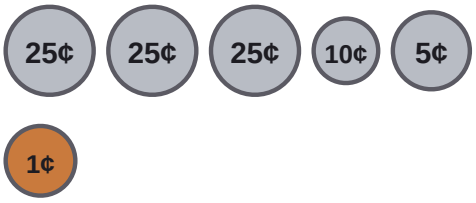

91¢

4



50¢

5



31¢

6



65¢

7



56¢

8



36¢