Name _____ Date _____

Counting coins puzzle no. 16

Count the coins. How many cents in each group?

1



_____

2



_____

3



_____

4



_____

5



_____

6



_____

7

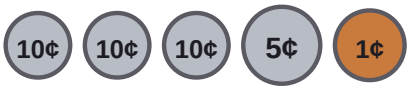

_____

8



_____

Name _____ Date _____

Answer key: Counting coins puzzle no. 16

Count the coins. How many cents in each group?

1



32¢

2



22¢

3



35¢

4



25¢

5



17¢

6



26¢

7

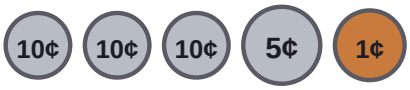

36¢

8



16¢