Name _____ Date _____

Counting coins puzzle no. 6

Count the coins. How many cents in each group?

1



_____

2



_____

3



_____

4



_____

5



_____

6



_____

7



_____

8



_____

Name _____ Date _____

Answer key: Counting coins puzzle no. 6

Count the coins. How many cents in each group?

1



17¢

2



21¢

3



21¢

4



14¢

5



18¢

6



25¢

7



42¢

8



46¢