Name _____ Date _____

Counting coins puzzle no. 8

Count the coins. How many cents in each group?

1



_____

2



_____

3



_____

4



_____

5



_____

6



_____

7



_____

8



_____

Name _____ Date _____

Answer key: Counting coins puzzle no. 8

Count the coins. How many cents in each group?

1



12¢

2



32¢

3



21¢

4



26¢

5



32¢

6



35¢

7



37¢

8



31¢