Name _____ Date _____

Dollars and coins puzzle no. 1

Count the coins and dollar bills. Write each total like $1.35.

1



_____

2

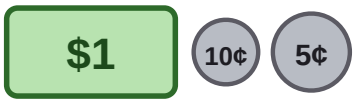

_____

3



_____

4



_____

5

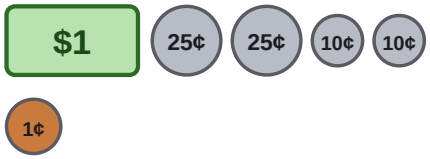

_____

6

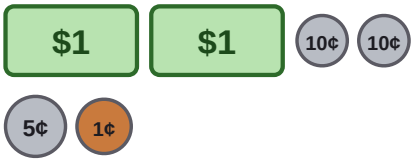

_____

7



_____

8



_____

9

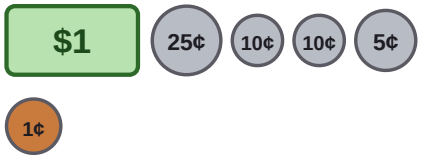

_____

10

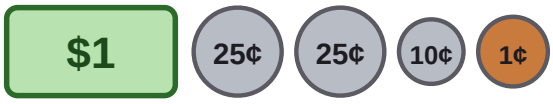

_____

Name _____ Date _____

Answer key: Dollars and coins puzzle no. 1

Count the coins and dollar bills. Write each total like $1.35.

1



$1.51

2

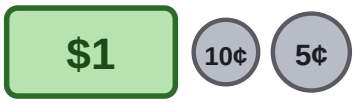

$1.15

3



$2.07

4



$1.30

5

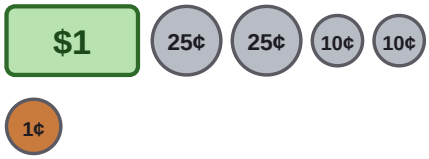

$1.71

6

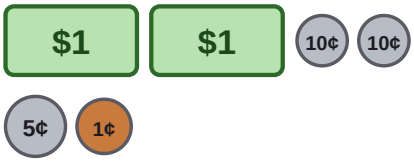

$2.26

7



$1.16

8



$2.21

9

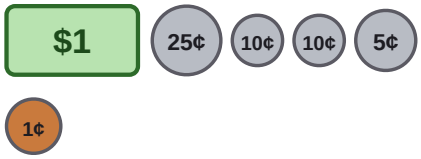

$1.51

10

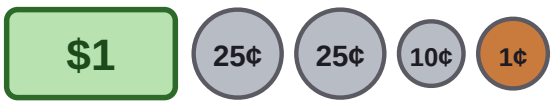

$1.61