Name _____ Date _____

Dollars and coins puzzle no. 10

Count the coins and dollar bills. Write each total like $1.35.

1



_____

2

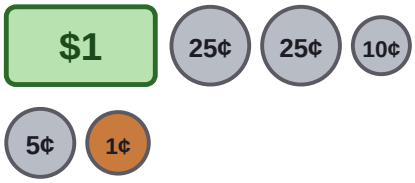

_____

3



_____

4



_____

5



_____

6

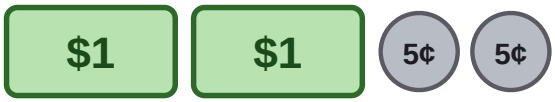

_____

7



_____

8



_____

9



_____

10

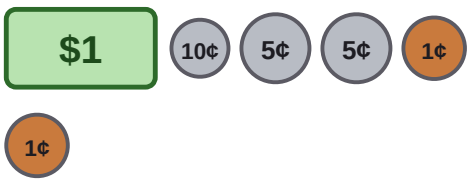

_____

Name _____ Date _____

Answer key: Dollars and coins puzzle no. 10

Count the coins and dollar bills. Write each total like $1.35.

1



$2.25

2

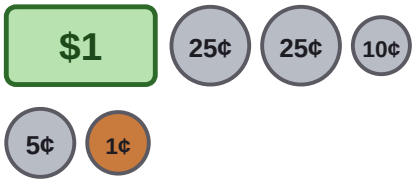

$1.66

3



$1.27

4



$2.01

5



$2.05

6

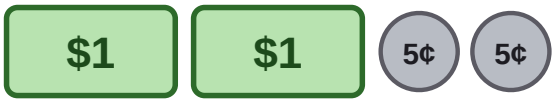

$2.10

7



$1.40

8



$1.15

9



$1.46

10

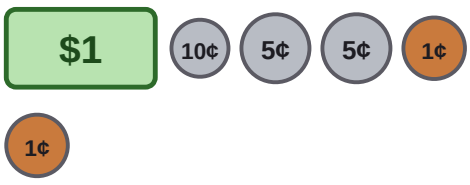

$1.22