Name _____ Date _____

Dollars and coins puzzle no. 11

Count the coins and dollar bills. Write each total like $1.35.

1

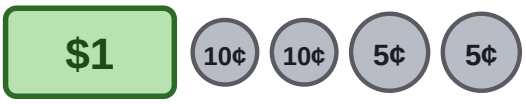

_____

2



_____

3

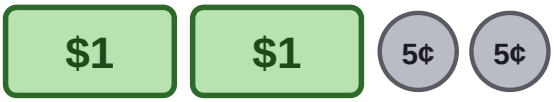

_____

4



_____

5



_____

6

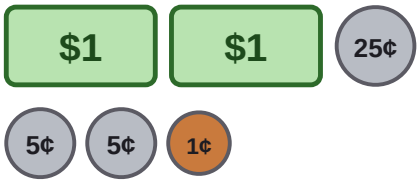

_____

7



_____

8

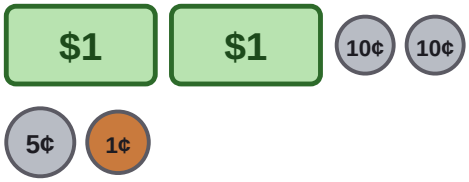

_____

9

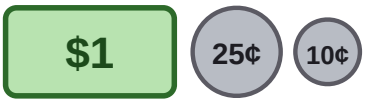

_____

10



_____

Name _____ Date _____

Answer key: Dollars and coins puzzle no. 11

Count the coins and dollar bills. Write each total like $1.35.

1



$1.30

2



$1.55

3

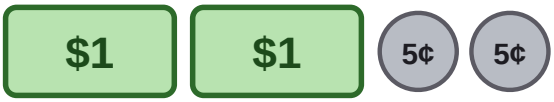

$2.10

4



$2.50

5



$2.12

6

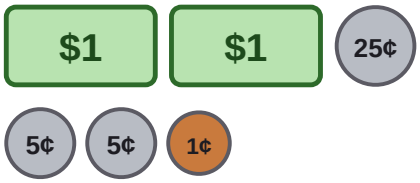

$2.36

7



$2.40

8

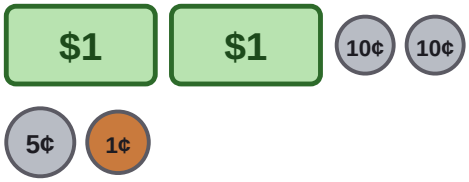

$2.26

9

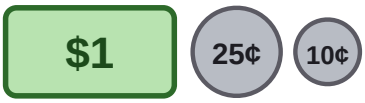

$1.35

10



$2.12