Name _____ Date _____

Dollars and coins puzzle no. 12

Count the coins and dollar bills. Write each total like $1.35.

1

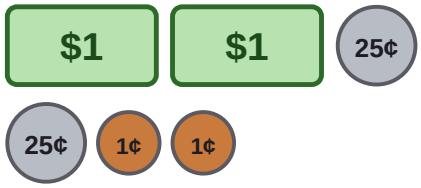

_____

2



_____

3



_____

4



_____

5

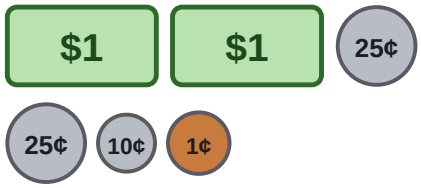

_____

6



_____

7

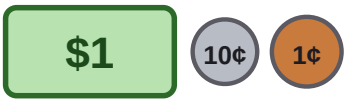

_____

8



_____

9



_____

10

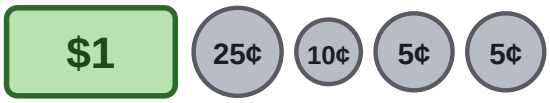

_____

Name _____ Date _____

Answer key: Dollars and coins puzzle no. 12

Count the coins and dollar bills. Write each total like $1.35.

1

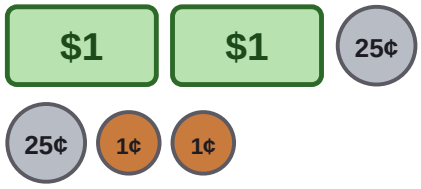

$2.52

2



$1.60

3



$1.21

4



$2.36

5

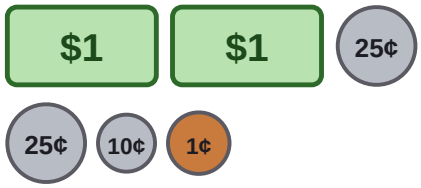

$2.61

6



$1.26

7

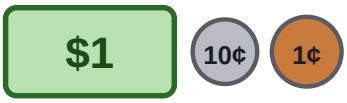

$1.11

8



$2.07

9



$2.05

10

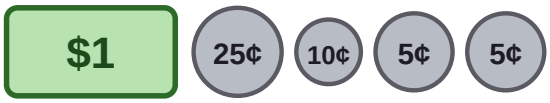

$1.45