Name _____ Date _____

Dollars and coins puzzle no. 13

Count the coins and dollar bills. Write each total like $1.35.

1



_____

2



_____

3

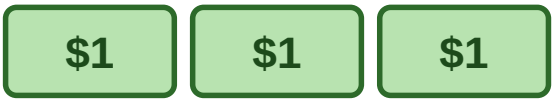

_____

4

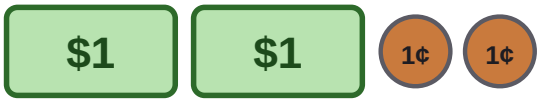

_____

5

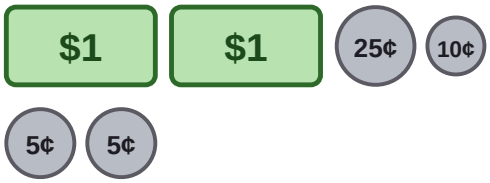

_____

6



_____

7



_____

8

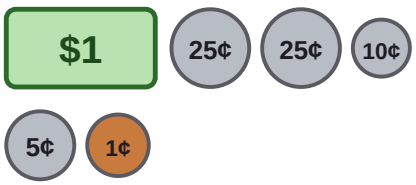

_____

9

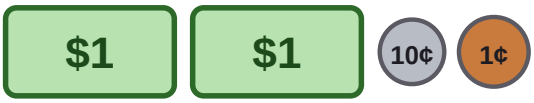

_____

10

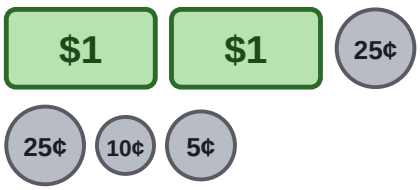

_____

Name _____ Date _____

Answer key: Dollars and coins puzzle no. 13

Count the coins and dollar bills. Write each total like $1.35.

1



$1.35

2



$2.30

3

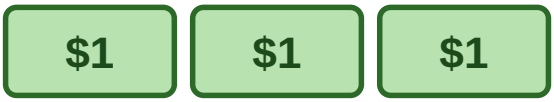

$3.00

4

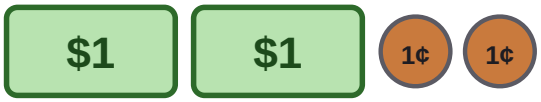

$2.02

5

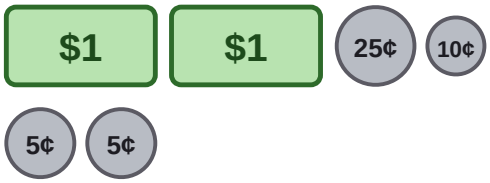

$2.45

6



$2.01

7



$1.17

8

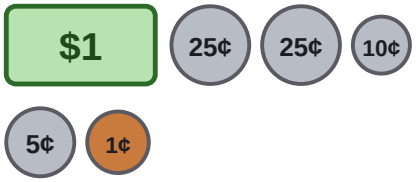

$1.66

9

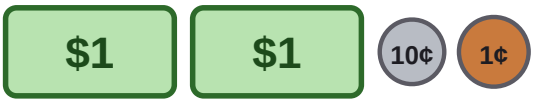

$2.11

10

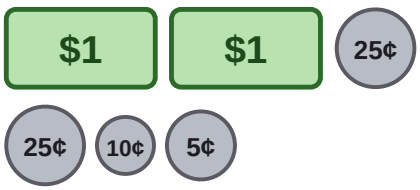

$2.65