Name _____ Date _____

Dollars and coins puzzle no. 14

Count the coins and dollar bills. Write each total like $1.35.

1



_____

2



_____

3



_____

4



_____

5

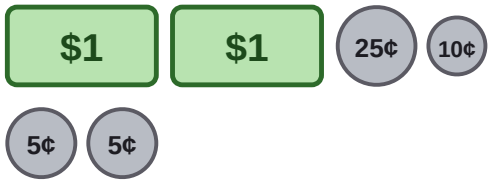

_____

6



_____

7



_____

8

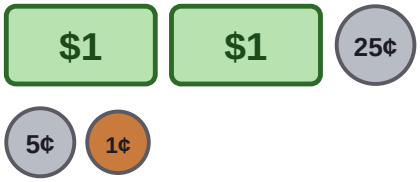

_____

9

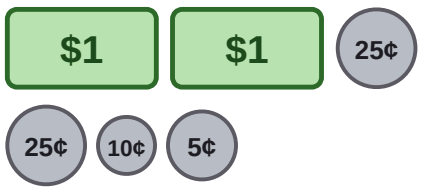

_____

10



_____

Name _____ Date _____

Answer key: Dollars and coins puzzle no. 14

Count the coins and dollar bills. Write each total like $1.35.

1



$2.40

2



$1.26

3



$1.25

4



$2.05

5

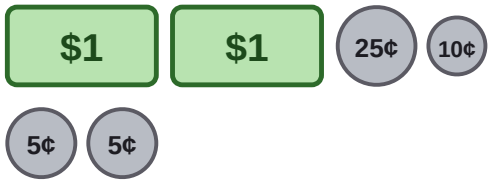

$2.45

6



$2.22

7



$2.21

8

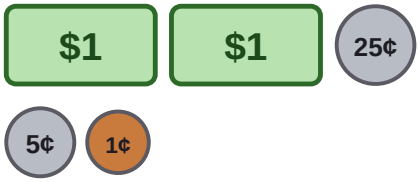

$2.31

9

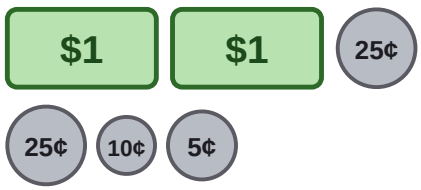

$2.65

10



$2.01