Name _____ Date _____

Dollars and coins puzzle no. 15

Count the coins and dollar bills. Write each total like $1.35.

1



_____

2



_____

3

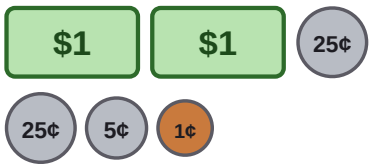

_____

4

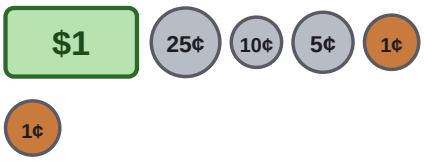

_____

5



_____

6



_____

7



_____

8



_____

9



_____

10



_____

Name _____ Date _____

Answer key: Dollars and coins puzzle no. 15

Count the coins and dollar bills. Write each total like $1.35.

1



$2.37

2



$1.51

3

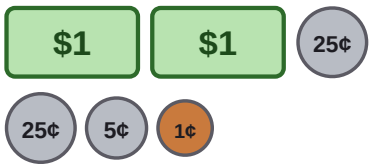

$2.56

4

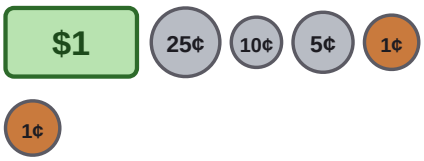

$1.42

5



$2.10

6



$1.36

7



$2.45

8



$1.50

9



$1.35

10



$1.20