Name _____ Date _____

Dollars and coins puzzle no. 16

Count the coins and dollar bills. Write each total like $1.35.

1



_____

2



_____

3



_____

4

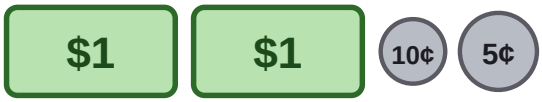

_____

5



_____

6

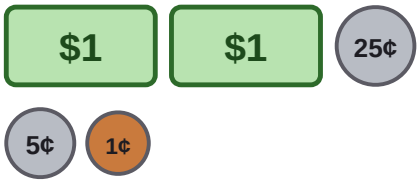

_____

7



_____

8



_____

9

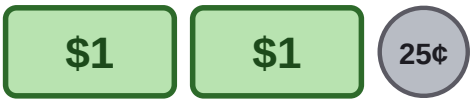

_____

10

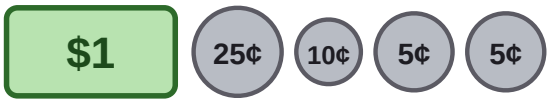

_____

Name _____ Date _____

Answer key: Dollars and coins puzzle no. 16

Count the coins and dollar bills. Write each total like $1.35.

1



$1.30

2



$2.07

3



$2.21

4

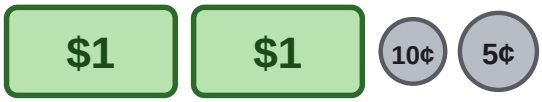

$2.15

5



$2.05

6

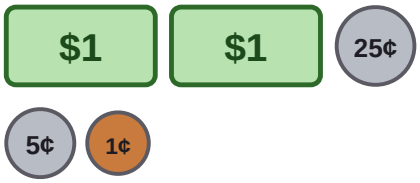

$2.31

7



$2.55

8



$1.45

9

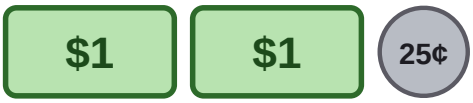

$2.25

10

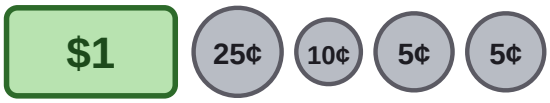

$1.45