Name _____ Date _____

Dollars and coins puzzle no. 17

Count the coins and dollar bills. Write each total like $1.35.

1

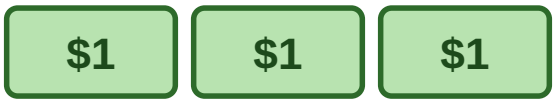

_____

2



_____

3



_____

4

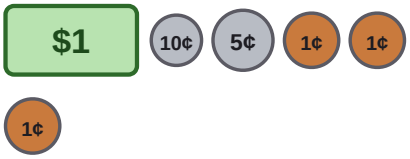

_____

5



_____

6



_____

7

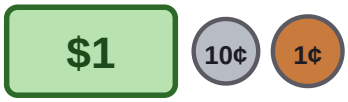

_____

8

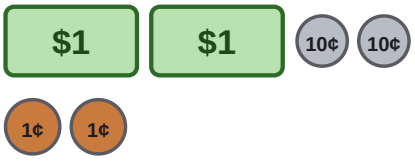

_____

9

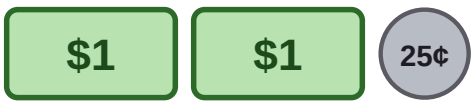

_____

10



_____

Name _____ Date _____

Answer key: Dollars and coins puzzle no. 17

Count the coins and dollar bills. Write each total like $1.35.

1

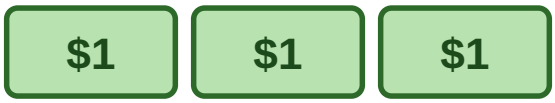

$3.00

2



$2.01

3



$1.41

4

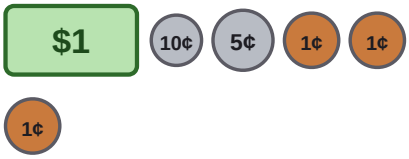

$1.18

5



$1.28

6



$1.30

7

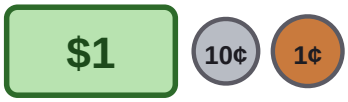

$1.11

8

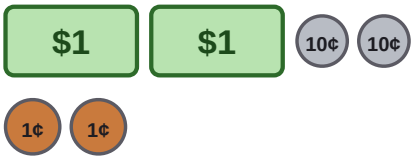

$2.22

9

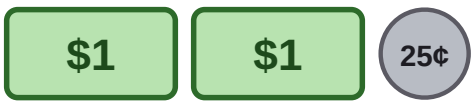

$2.25

10



$1.35