Name _____ Date _____

Dollars and coins puzzle no. 18

Count the coins and dollar bills. Write each total like $1.35.

1



_____

2

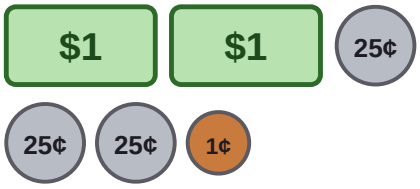

_____

3



_____

4

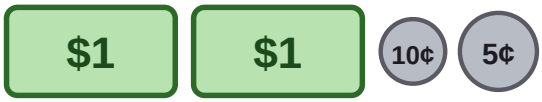

_____

5



_____

6

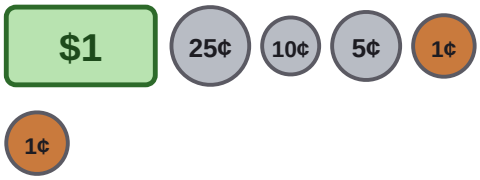

_____

7

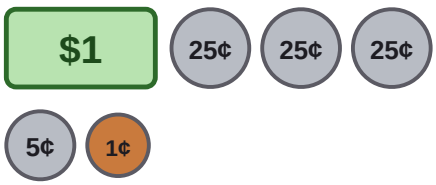

_____

8

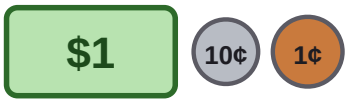

_____

9



_____

10

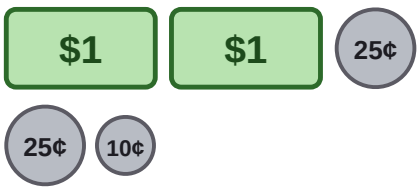

_____

Name _____ Date _____

Answer key: Dollars and coins puzzle no. 18

Count the coins and dollar bills. Write each total like $1.35.

1



$1.61

2

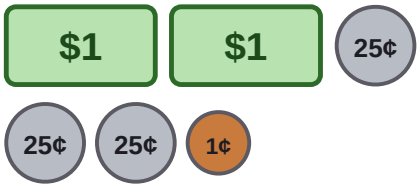

$2.76

3



$2.12

4

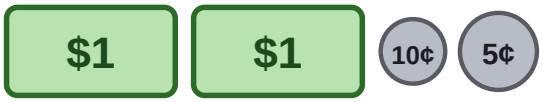

$2.15

5



$2.16

6

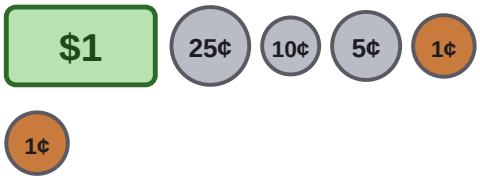

$1.42

7

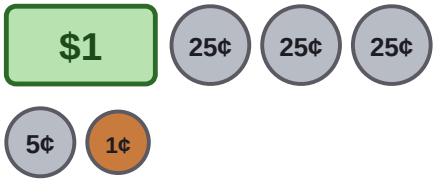

$1.81

8

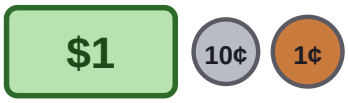

$1.11

9



$1.36

10

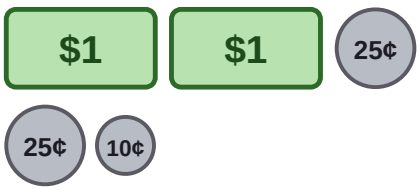

$2.60