Name _____ Date _____

Dollars and coins puzzle no. 19

Count the coins and dollar bills. Write each total like $1.35.

1

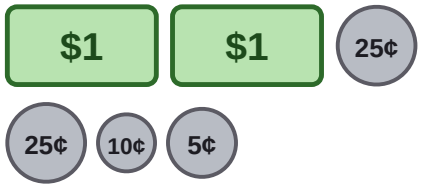

_____

2



_____

3

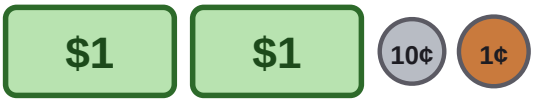

_____

4



_____

5



_____

6

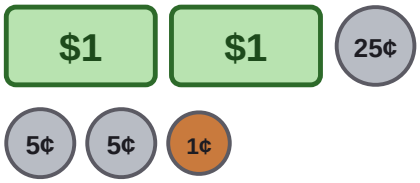

_____

7



_____

8



_____

9

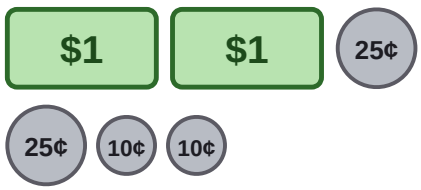

_____

10

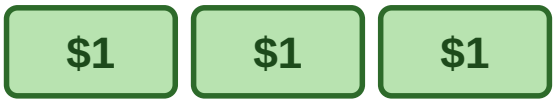

_____

Name _____ Date _____

Answer key: Dollars and coins puzzle no. 19

Count the coins and dollar bills. Write each total like $1.35.

1

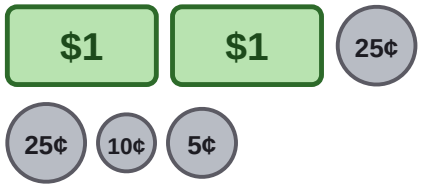

$2.65

2



$2.05

3

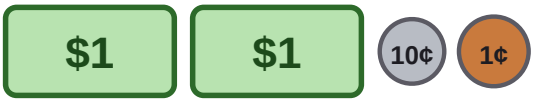

$2.11

4



$2.40

5



$1.50

6

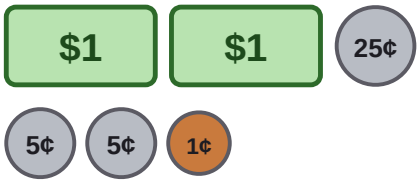

$2.36

7



$1.26

8



$1.12

9

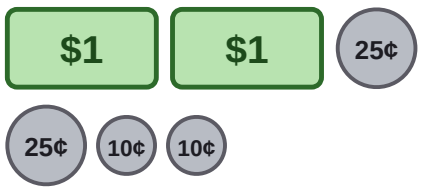

$2.70

10

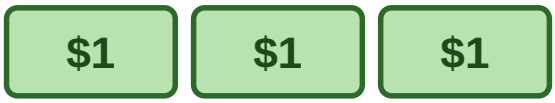

$3.00