Name _____ Date _____

Dollars and coins puzzle no. 3

Count the coins and dollar bills. Write each total like $1.35.

1

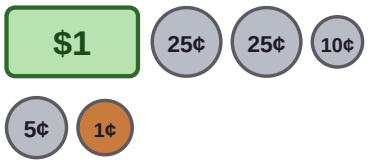

_____

2



_____

3



_____

4



_____

5

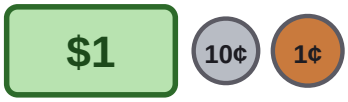

_____

6



_____

7



_____

8

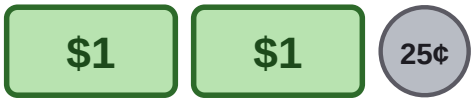

_____

9



_____

10



_____

Name _____ Date _____

Answer key: Dollars and coins puzzle no. 3

Count the coins and dollar bills. Write each total like $1.35.

1

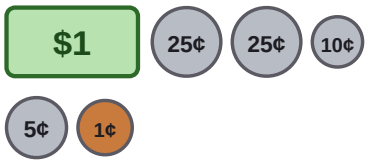

$1.66

2



$1.35

3



$1.50

4



$1.36

5

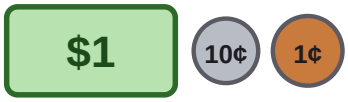

$1.11

6



$1.31

7



$1.32

8

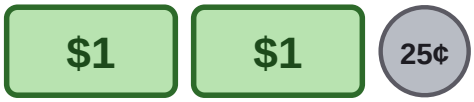

$2.25

9



$1.25

10



$2.26