Name _____ Date _____

Dollars and coins puzzle no. 4

Count the coins and dollar bills. Write each total like $1.35.

1



_____

2



_____

3



_____

4



_____

5

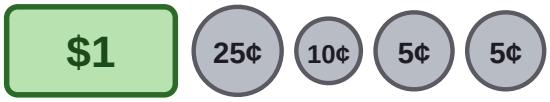

_____

6

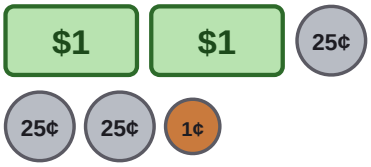

_____

7

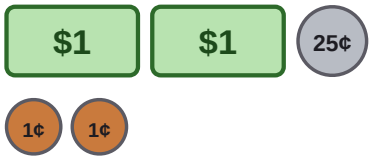

_____

8

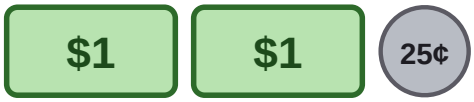

_____

9

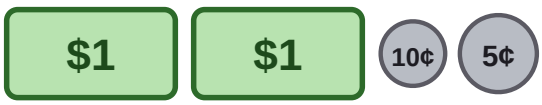

_____

10



_____

Name _____ Date _____

Answer key: Dollars and coins puzzle no. 4

Count the coins and dollar bills. Write each total like $1.35.

1



$2.16

2



$1.30

3



$1.50

4



$1.26

5

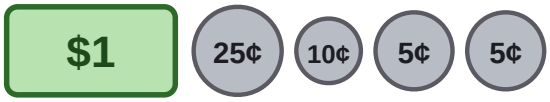

$1.45

6

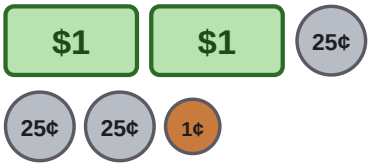

$2.76

7

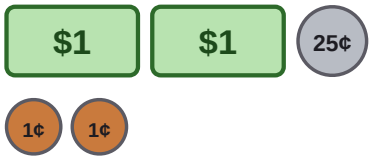

$2.27

8

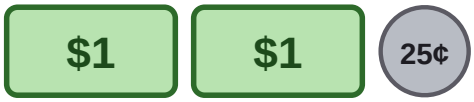

$2.25

9

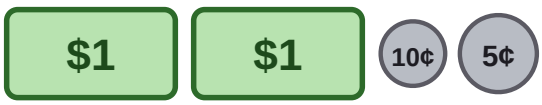

$2.15

10



$2.50