Name _____ Date _____

Dollars and coins puzzle no. 5

Count the coins and dollar bills. Write each total like $1.35.

1



_____

2



_____

3



_____

4



_____

5



_____

6



_____

7

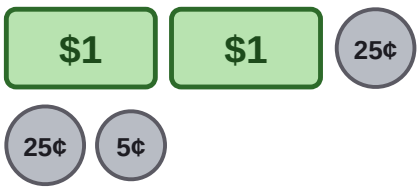

_____

8



_____

9



_____

10



_____

Name _____ Date _____

Answer key: Dollars and coins puzzle no. 5

Count the coins and dollar bills. Write each total like $1.35.

1



$1.16

2



$1.27

3



$1.25

4



$2.21

5



$2.26

6



$2.20

7

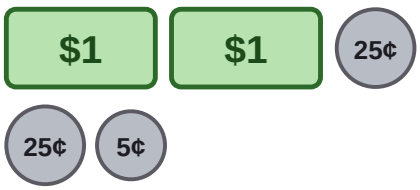

$2.55

8



$1.17

9



$1.37

10



$2.03