Name _____ Date _____

# Dollars and coins puzzle no. 5

Count the coins and dollar bills. Write each total like $1.35.

1




_____

2




_____

3




_____

4




_____

5




_____

6




_____

7

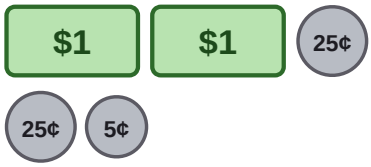


_____

8




_____

9




_____

10




_____

Name _____ Date _____

# Answer key: Dollars and coins puzzle no. 5

Count the coins and dollar bills. Write each total like $1.35.

1




**$1.16**

2




**$1.27**

3




**$1.25**

4




**$2.21**

5




**$2.26**

6




**$2.20**

7

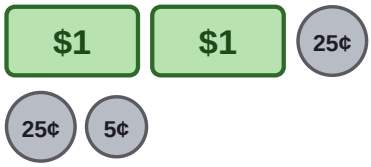


**$2.55**

8




**$1.17**

9




**$1.37**

10




**$2.03**