Name _____ Date _____

Dollars and coins puzzle no. 6

Count the coins and dollar bills. Write each total like $1.35.

1



_____

2

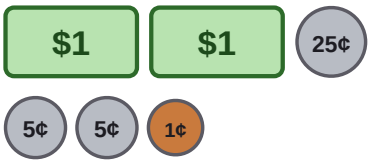

_____

3

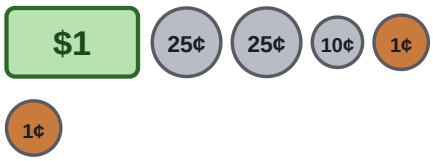

_____

4

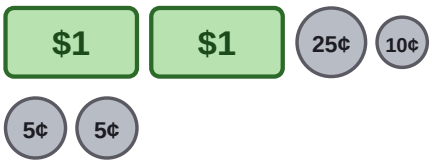

_____

5



_____

6

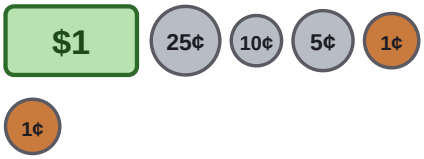

_____

7



_____

8

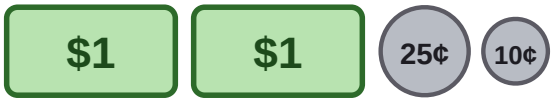

_____

9



_____

10



_____

Name _____ Date _____

Answer key: Dollars and coins puzzle no. 6

Count the coins and dollar bills. Write each total like $1.35.

1



$1.40

2

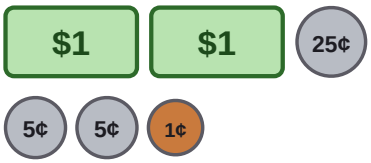

$2.36

3

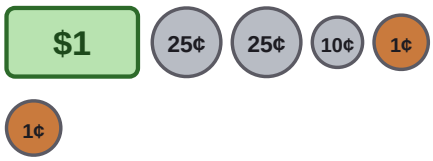

$1.62

4

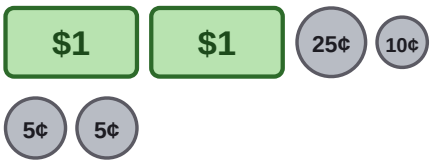

$2.45

5



$1.41

6

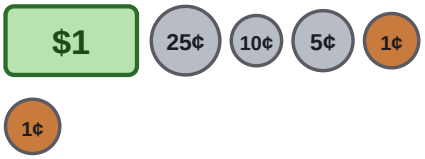

$1.42

7



$2.05

8

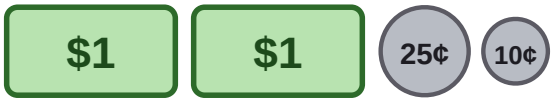

$2.35

9



$2.45

10



$1.35