Name _____ Date _____

Dollars and coins puzzle no. 7

Count the coins and dollar bills. Write each total like $1.35.

1



_____

2

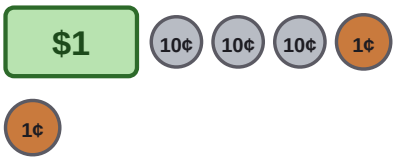

_____

3

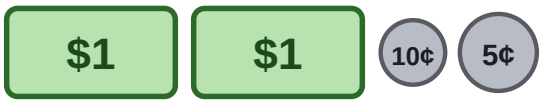

_____

4

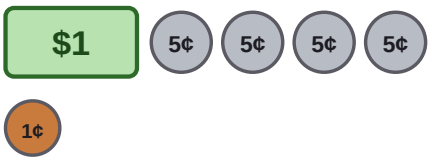

_____

5

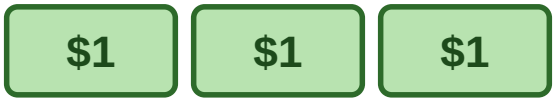

_____

6



_____

7



_____

8



_____

9



_____

10



_____

Name _____ Date _____

Answer key: Dollars and coins puzzle no. 7

Count the coins and dollar bills. Write each total like $1.35.

1

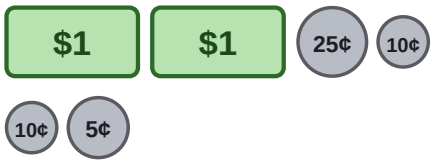

$2.50

2

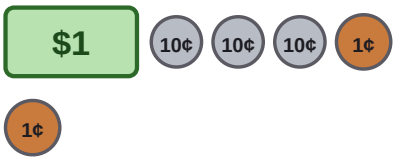

$1.32

3

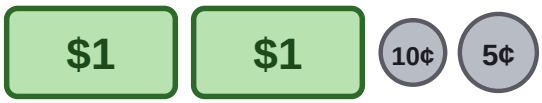

$2.15

4

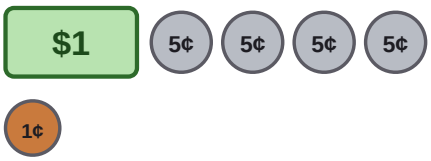

$1.21

5

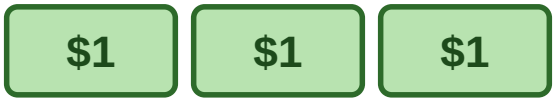

$3.00

6



$1.32

7



$1.40

8



$2.40

9



$1.20

10



$1.15