Name _____ Date _____

Dollars and coins puzzle no. 8

Count the coins and dollar bills. Write each total like $1.35.

1



_____

2



_____

3



_____

4



_____

5

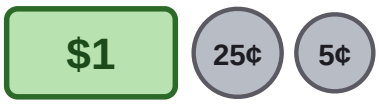

_____

6



_____

7



_____

8

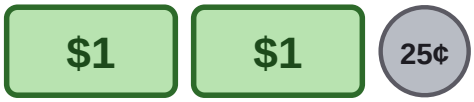

_____

9



_____

10

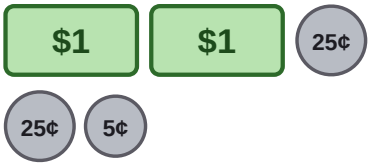

_____

Name _____ Date _____

Answer key: Dollars and coins puzzle no. 8

Count the coins and dollar bills. Write each total like $1.35.

1



$1.31

2



$1.12

3



$2.05

4



$1.26

5

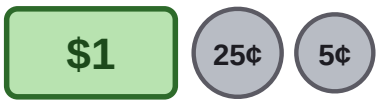

$1.30

6



$1.35

7



$2.50

8

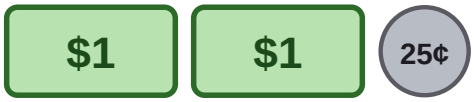

$2.25

9



$2.06

10

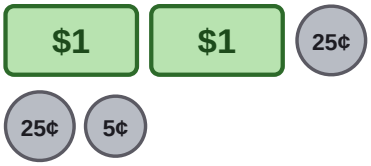

$2.55