Name _____ Date _____

Half past telling time worksheet no. 14

What time does each clock show? Write it like 3:30.

1 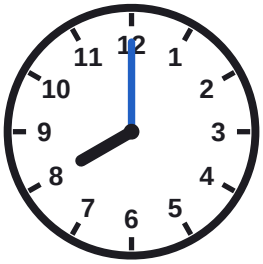

_____

2 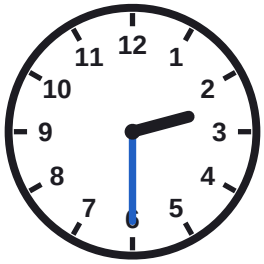

_____

3 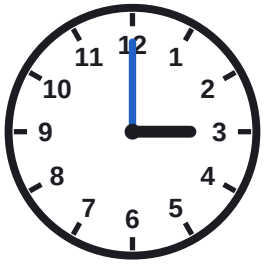

_____

4 

_____

5 

_____

6 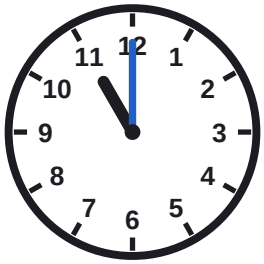

_____

7 

_____

8 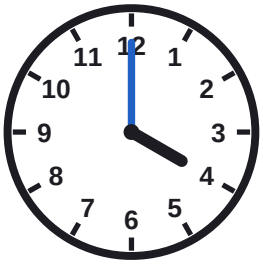

_____

Name _____ Date _____

Answer key: Half past telling time worksheet no. 14

What time does each clock show? Write it like 3:30.

1

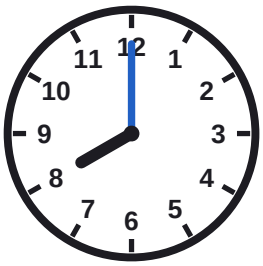

8:00

2



2:30

3

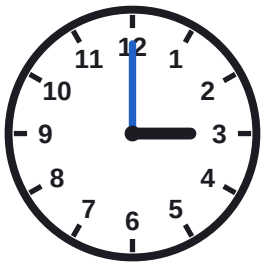

3:00

4



10:30

5



3:30

6



11:00

7



8:30

8



4:00