Name _____ Date _____

Half past telling time worksheet no. 16

What time does each clock show? Write it like 3:30.

1 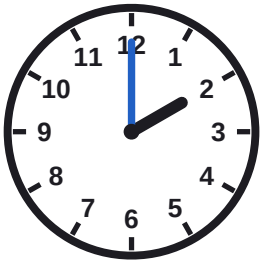

_____

2 

_____

3 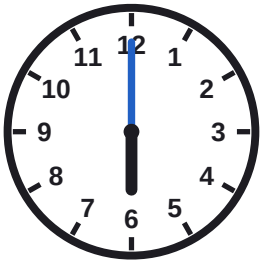

_____

4 

_____

5 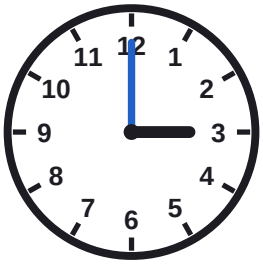

_____

6 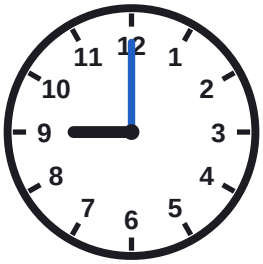

_____

7 

_____

8 

_____

Name _____ Date _____

Answer key: Half past telling time worksheet no. 16

What time does each clock show? Write it like 3:30.

1

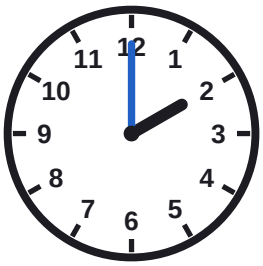

2:00

2



5:30

3



6:00

4



10:00

5

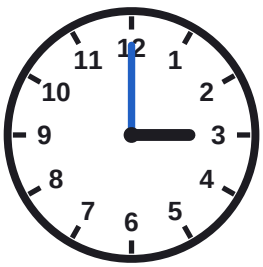

3:00

6



9:00

7



10:30

8



6:30