Name _____ Date _____

Half past telling time worksheet no. 2

What time does each clock show? Write it like 3:30.

1

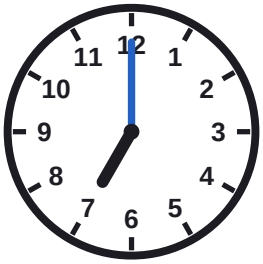

_____

2

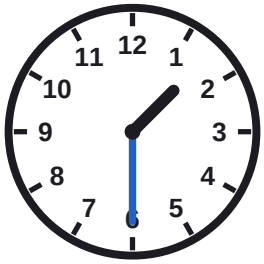

_____

3

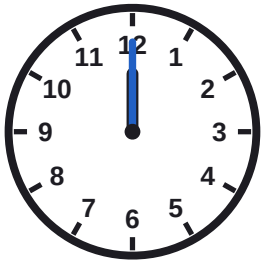

_____

4



_____

5



_____

6

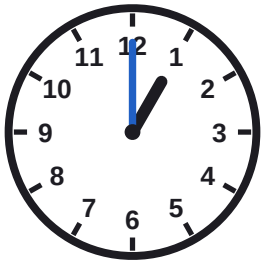

_____

7



_____

8

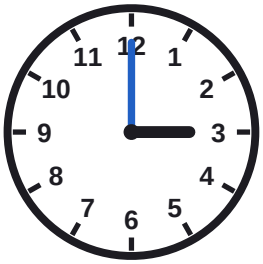

_____

Name _____ Date _____

Answer key: Half past telling time worksheet no. 2

What time does each clock show? Write it like 3:30.

1



7:00

2



1:30

3



12:00

4



10:30

5



11:30

6



1:00

7



6:00

8

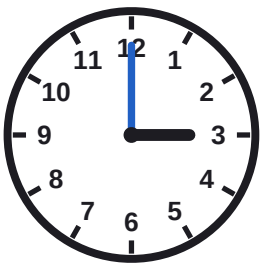

3:00