Name _____ Date _____

Half past telling time worksheet no. 4

What time does each clock show? Write it like 3:30.

1 

_____

2 

_____

3 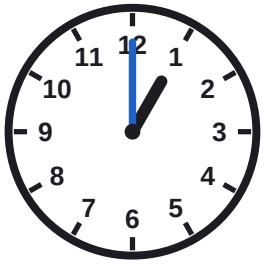

_____

4 

_____

5 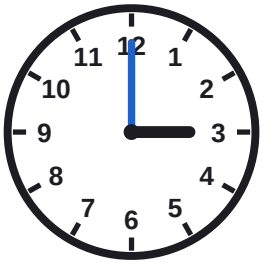

_____

6 

_____

7 

_____

8 

_____

Name _____ Date _____

Answer key: Half past telling time worksheet no. 4

What time does each clock show? Write it like 3:30.

1



11:30

2



9:30

3



1:00

4



4:30

5

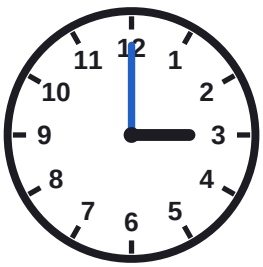

3:00

6



7:30

7



6:30

8



3:30