Name _____ Date _____

Half past telling time worksheet no. 5

What time does each clock show? Write it like 3:30.

1 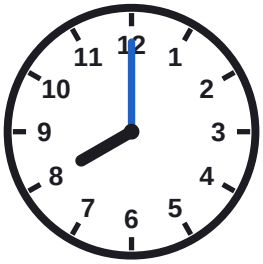

_____

2 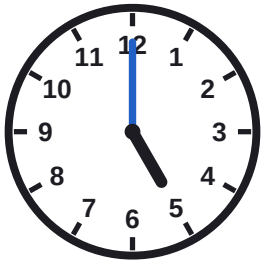

_____

3 

_____

4 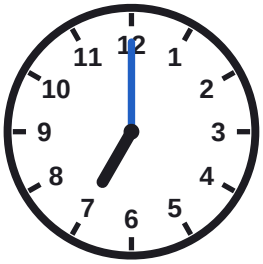

_____

5 

_____

6 

_____

7 

_____

8 

_____

Name _____ Date _____

Answer key: Half past telling time worksheet no. 5

What time does each clock show? Write it like 3:30.

1

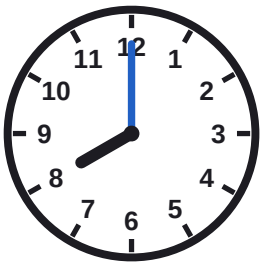

8:00

2

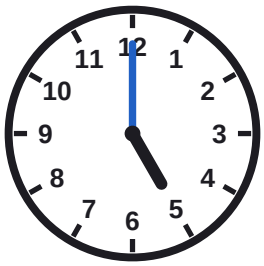

5:00

3



7:30

4



7:00

5



4:00

6



11:00

7



2:00

8



1:00