Name _____ Date _____

Half past telling time worksheet no. 6

What time does each clock show? Write it like 3:30.

1 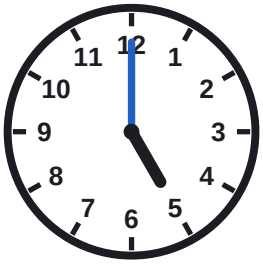

_____

2 

_____

3 

_____

4 

_____

5 

_____

6 

_____

7 

_____

8 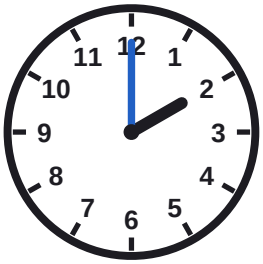

_____

Name _____ Date _____

Answer key: Half past telling time worksheet no. 6

What time does each clock show? Write it like 3:30.

1

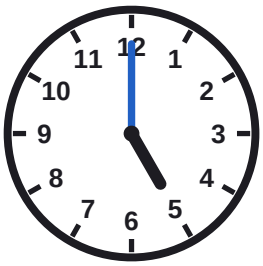

5:00

2



11:30

3



8:30

4



5:30

5



1:30

6



9:30

7



12:30

8



2:00