Name _____ Date _____

Half past telling time worksheet no. 9

What time does each clock show? Write it like 3:30.

1



_____

2

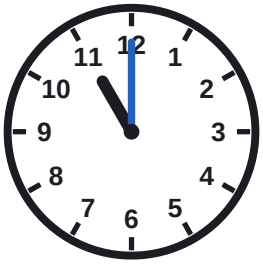

_____

3

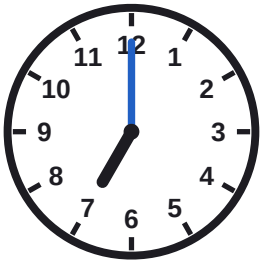

_____

4



_____

5



_____

6



_____

7

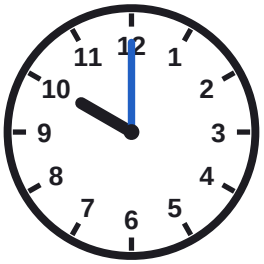

_____

8



_____

Name _____ Date _____

Answer key: Half past telling time worksheet no. 9

What time does each clock show? Write it like 3:30.

1



12:30

2



11:00

3



7:00

4



9:30

5



7:30

6



2:30

7



10:00

8



12:00