Name _____ Date _____

Quarter hour telling time worksheet no. 13

Read each clock to the quarter hour. Write the time like 4:15.

1 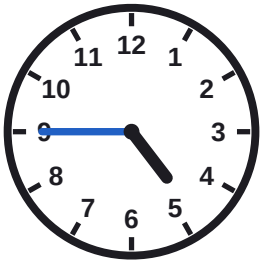

_____

2 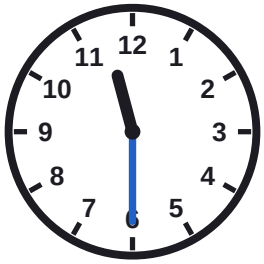

_____

3 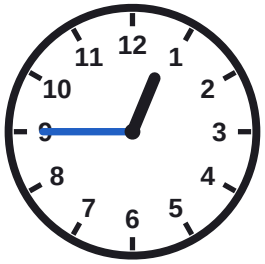

_____

4 

_____

5 

_____

6 

_____

7 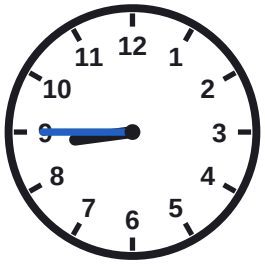

_____

8 

_____

Name _____ Date _____

Answer key: Quarter hour telling time worksheet no. 13

Read each clock to the quarter hour. Write the time like 4:15.

1



4:45

2



11:30

3



12:45

4



6:45

5



7:15

6



8:30

7



8:45

8



12:15