Name _____ Date _____

Quarter hour telling time worksheet no. 17

Read each clock to the quarter hour. Write the time like 4:15.

1 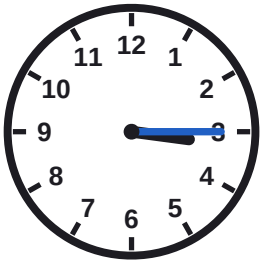

_____

2 

_____

3 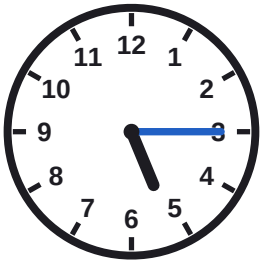

_____

4 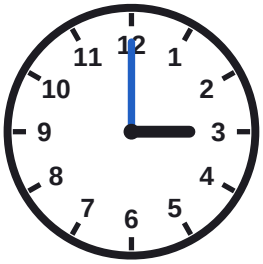

_____

5 

_____

6 

_____

7 

_____

8 

_____

Name _____ Date _____

Answer key: Quarter hour telling time worksheet no. 17

Read each clock to the quarter hour. Write the time like 4:15.

1

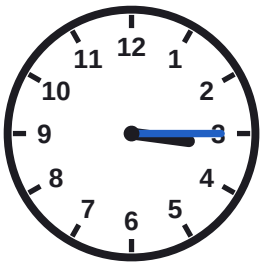

3:15

2

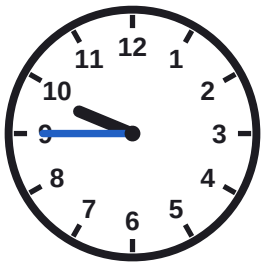

9:45

3



5:15

4

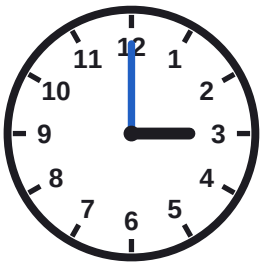

3:00

5



10:30

6



6:15

7



4:30

8



12:30